Wada Nirmiti Education Society's
GURUKUL GLOBAL SCHOOL
A. Y. - 2026-27

Name: _____

Date: **Roll No:** **Class: 1**

Subject: Maths **Fun with Numbers Chapter-8)**

A) Join the dot according to counting:



B) Fill in the correct TENS and ONES for the given numbers:

____ tens and ____ ones = 37	____ tens and ____ ones = 25
____ tens and ____ ones = 64	____ tens and ____ ones = 98
____ tens and ____ ones = 45	____ tens and ____ ones = 52
____ tens and ____ ones = 83	____ tens and ____ ones = 74

C) Count the bundles and ones and write the correct number in the box:

1. 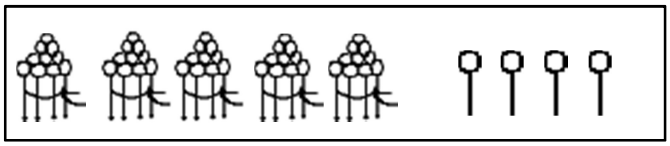

2. 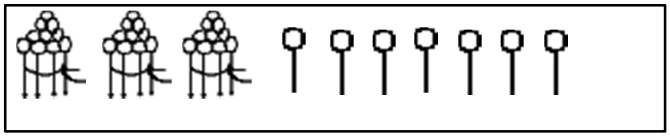

3. 

4. 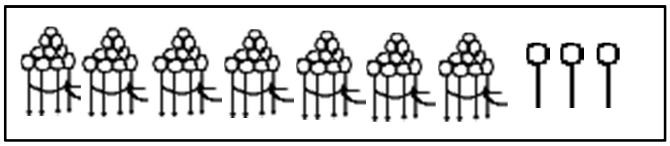

5. 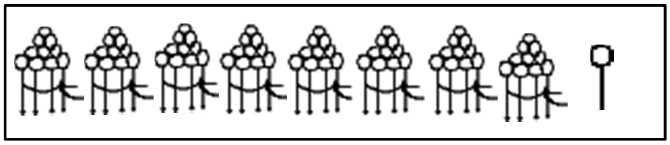

D) Write the numbers in words:

i. 78 - _____

ii. 65 - _____

iii. 94 - _____

iv. 51 - _____

v. 87 - _____

vi. 24 - _____

vii. 36 - _____