Wada Nirmiti Education Society's
GURUKUL GLOBAL SCHOOL
A. Y. - 2026-27

Name: _____
Date: **Roll No:**
Class: 1
Subject: Maths **Chapter-12: How much can we**

Q1:- Look at these coins and notes and write their denomination below.

a) 

b) 

_____ _____

c) 

d) 

e) 

_____ _____ _____

Q2:- Add the amount of following coins and notes:

 +  +  +  = _____

Q 3:- Add the amount of following coins and notes :

 +  +  = _____

Q4.Write the cost of following things if,

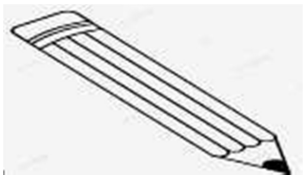

Cost of one pencil=₹5

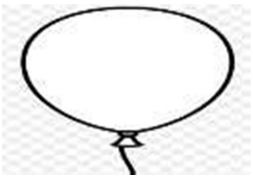

Cost of one balloon=₹ 10

(a)  ☐

(b) 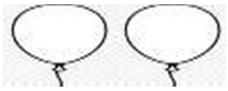 ☐

(c)  ☐

(d)  ☐

(e)  ☐

Q.5. Draw coins/notes for the given amount-

(a) ₹15
(b) ₹18
(c) ₹20
(d) ₹9
(e) ₹ 22